أتحقق من فهمي

الكسر كجزء من كل

أَتَحَقَّقُ مِنْ فَهْمي

أَكْتُبُ الْكَسْرَ الَّذي يُمَثِّلُ الْجُزْءَ الْمُلَوَّنَ:

1

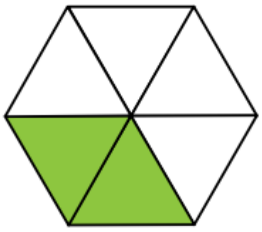

$\frac{2}{6}$

2

$\frac{4}{6}$

3



$\frac{5}{10}$

أُلَوِّنُ لِأُمَثِّلَ الْكَسْرَ الْمُعْطى:

4 $\frac{3}{4}$

5 $\frac{4}{7}$

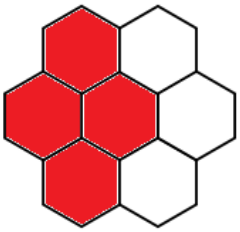

6 $\frac{9}{9}$