أسئلة كتاب التمارين

مقارنة الكسور

أُلَوِّنُ لِتَمْثيلِ كُلِّ كَسْرٍ، ثُمَّ أُقارِنُ مُسْتَعْمِلًا > أَوْ = أَوْ <:

1

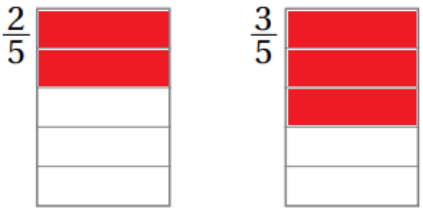

$\frac{2}{5}$ < $\frac{3}{5}$

2

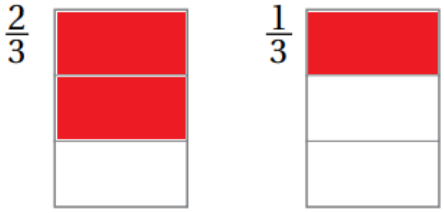

$\frac{2}{3}$ > $\frac{1}{3}$

3

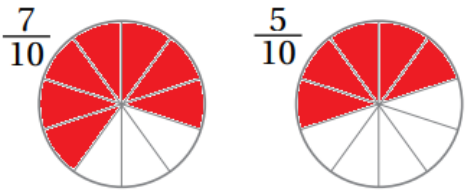

$\frac{7}{10}$ > $\frac{5}{10}$

4

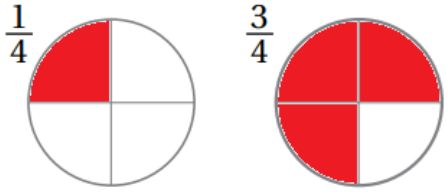

$\frac{1}{4}$ < $\frac{3}{4}$

أَكْتُبُ الْكَسْرَ الَّذي يُمَثِّلُ الْجُزْءَ الْمُظَلَّلَ، ثُمَّ أُقارِنُ مُسْتَعْمِلًا > أَوْ = أَوْ <:

5

$\frac{4}{5}$ > $\frac{3}{5}$

6

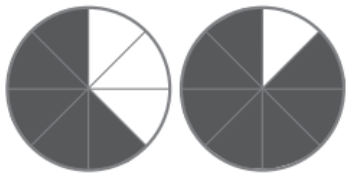

$\frac{5}{8}$ < $\frac{7}{8}$

أَسْتَعْمِلُ نَماذِجَ الْكُسورِ؛ لِأُقارِنَ مُسْتَعْمِلًا > أَوْ = أَوْ <:

1								
$\frac{1}{3}$			$\frac{1}{3}$			$\frac{1}{3}$		
$\frac{1}{6}$		$\frac{1}{6}$	$\frac{1}{6}$		$\frac{1}{6}$	$\frac{1}{6}$		$\frac{1}{6}$
$\frac{1}{9}$	$\frac{1}{9}$	$\frac{1}{9}$	$\frac{1}{9}$	$\frac{1}{9}$	$\frac{1}{9}$	$\frac{1}{9}$	$\frac{1}{9}$	$\frac{1}{9}$

7 $\frac{1}{6}$ < $\frac{1}{3}$

8 $\frac{2}{6}$ = $\frac{1}{3}$

9 $\frac{2}{9}$ > $\frac{1}{6}$

10 $\frac{2}{3}$ = $\frac{6}{9}$

11 $\frac{1}{6}$ > $\frac{1}{9}$

12 $\frac{1}{6}$ < $\frac{1}{3}$

13 $\frac{5}{9}$ < $\frac{2}{3}$

14 $\frac{1}{9}$ < $\frac{5}{6}$

15 $\frac{5}{6}$ < $\frac{8}{9}$

أَسْتَعْمِلُ خَطَّ الْأَعْدادِ؛ لِأُقارِنَ مُسْتَعْمِلًا > أَوْ = أَوْ <:

16

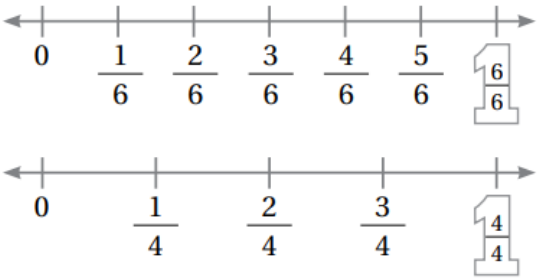

17

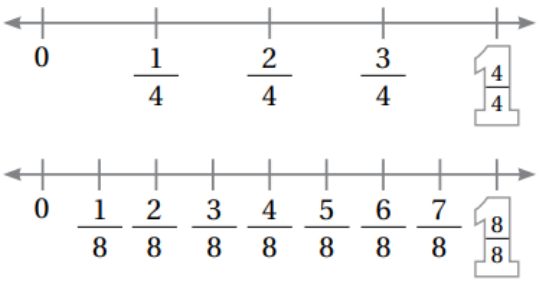

$\frac{4}{6}$ < $\frac{3}{4}$

$\frac{3}{4}$ = $\frac{6}{8}$